円周角の定理―３

「次の円において、∠χの大きさを求めなさい。」

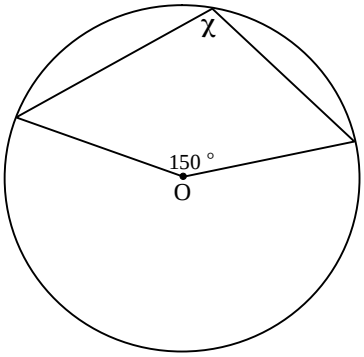

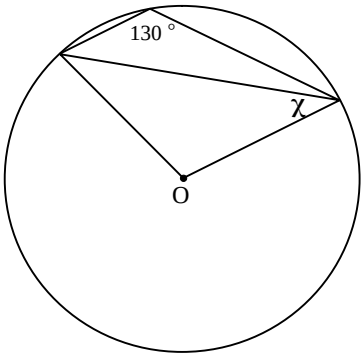

答＿＿＿＿＿＿＿＿　　答＿＿＿＿＿＿＿＿

※　“ 円 ”の中には「　　」が隠れている。

1，次の円において、∠χの大きさを求めなさい。

①

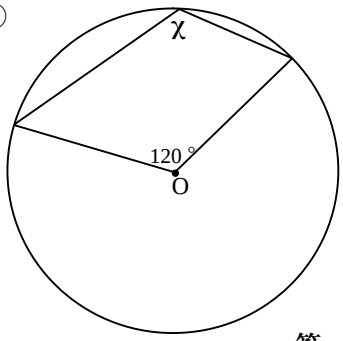

答＿＿＿＿＿＿＿＿

②

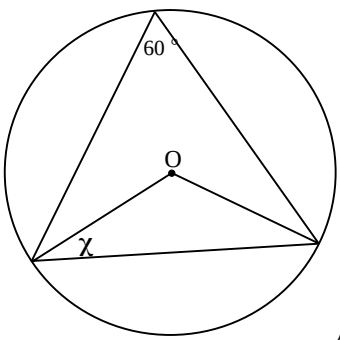

答＿＿＿＿＿＿＿＿

③

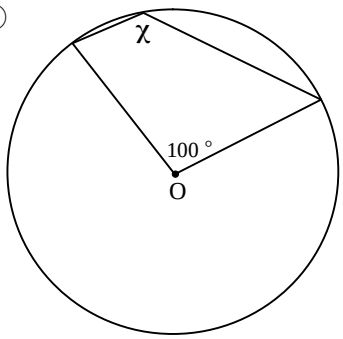

答＿＿＿＿＿＿＿＿

④

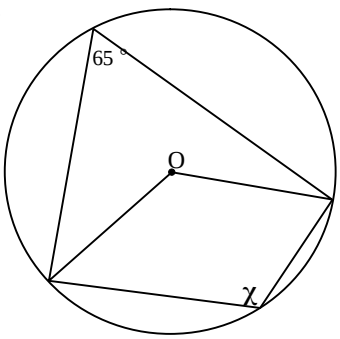

答＿＿＿＿＿＿＿＿